Time & Timetables: Easy Practice Paper 1

Q1. What time is shown on this clock?

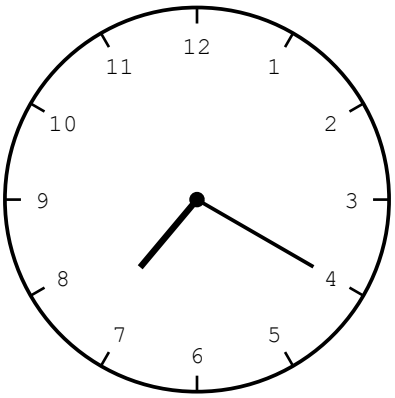

A. 4:35 B. 7:04 C. 7:20 D. 7:40 E. 8:20

Q2. What is 3:45 pm on a 24-hour clock?

A. 03:45 B. 13:45 C. 14:45 D. 15:45 E. 17:45

Q3. A lesson starts at 09:15 and finishes at 09:50. How long is the lesson?

A. 35 minutes

B. 40 minutes

C. 45 minutes

D. 55 minutes

E. 1 hour 5 minutes

myfreeschool

Q4. Use the bus timetable. What time does Bus B leave Mill Lane?

Bus stop	Bus A	Bus B	Bus C
Oak Road	08:15	09:05	09:55
Mill Lane	08:24	09:14	10:04
Hillside	08:37	09:27	10:17
Station	08:50	09:40	10:30

A. 09:05 B. 09:14 C. 09:27 D. 09:40 E. 10:04

Q5. How many minutes are there in 2 hours?

A. 120 B. 150 C. 180 D. 200 E. 240

Q6. What time is shown on this clock?

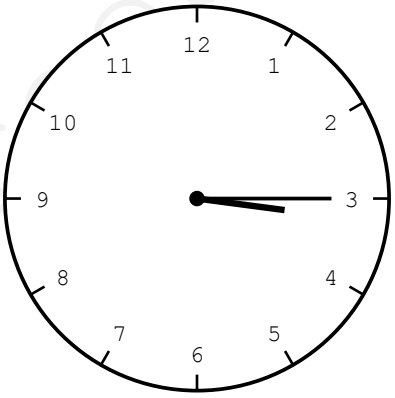

A. Quarter to 3

B. Quarter past 3

C. Half past 3

D. Quarter past 4

E. Three o'clock

myfreeschool

Q7. Use the bus timetable. How long does Bus A take to travel from Oak Road to Hillside?

Bus stop	Bus A	Bus B	Bus C
Oak Road	08:15	09:05	09:55
Mill Lane	08:24	09:14	10:04
Hillside	08:37	09:27	10:17
Station	08:50	09:40	10:30

A. 12 minutes

B. 20 minutes

C. 22 minutes

D. 25 minutes

E. 37 minutes

Q8. How many days are there in a leap year?

A. 360 B. 362 C. 364 D. 365 E. 366

Q9. Look at the calendar for this month. What day of the week is the 14th?

Mon	Tue	Wed	Thu	Fri	Sat	Sun
		1	2	3	4	5
6	7	8	9	10	11	12
13	14	15	16	17	18	19
20	21	22	23	24	25	26
27	28	29	30	31		

A. Monday B. Tuesday C. Wednesday D. Thursday E. Friday

Q10. How many seconds are there in 3 minutes?

A. 30 B. 60 C. 120 D. 180 E. 300

myfreeschool

Q11. A clock shows 18:30. What is this time using am or pm?

A. 6:30 am B. 6:30 pm C. 8:30 am D. 8:30 pm E. 10:30 pm

Q12. A film starts at 14:20 and lasts 90 minutes. What time does it finish?

A. 15:10 B. 15:20 C. 15:50 D. 16:10 E. 16:50

Q13. What time is shown on this clock?

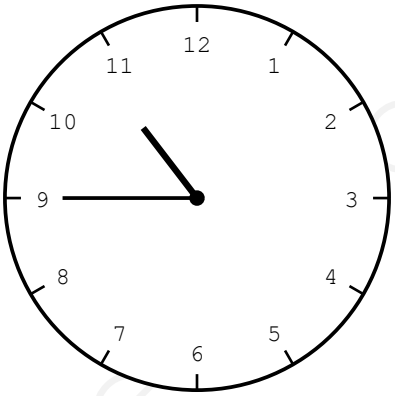

A. Quarter past 10

B. Half past 10

C. Quarter to 10

D. Quarter to 11

E. Quarter past 11

myfreeschool

Q14. Use the bus timetable. Amara reaches Hillside at 09:30. How long must she wait for the next bus?

Bus stop	Bus A	Bus B	Bus C
Oak Road	08:15	09:05	09:55
Mill Lane	08:24	09:14	10:04
Hillside	08:37	09:27	10:17
Station	08:50	09:40	10:30

A. 37 minutes

B. 40 minutes

C. 43 minutes

D. 47 minutes

E. 57 minutes

Q15. How many months of the year have 31 days?

A. 5 B. 6 C. 7 D. 8 E. 12

myfreeschool